Prénom : …… Date : ……

LES MASSES (03)

L'utilisation d'une balance

- Voici une boîte de masses marquées :

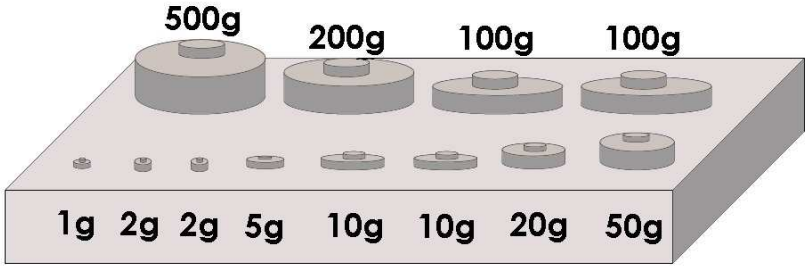

- Quelle masse totale obtient-on en utilisant toutes les masses ?

……

……

- Complète le plateau de droite avec les masses de la boîte afin d'obtenir l'équilibre :

1./

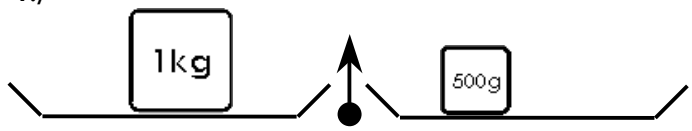

2./

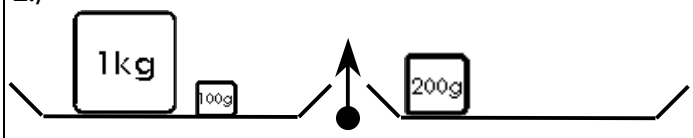

3./

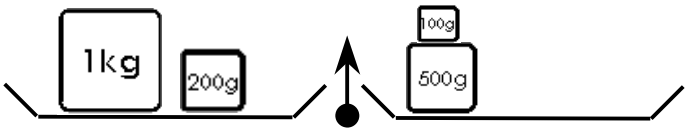

4./

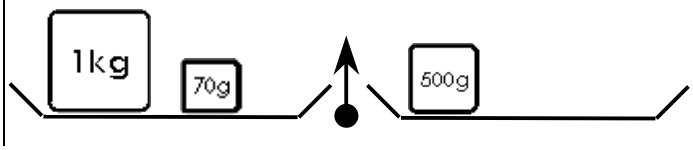

- Dessine les masses nécessaires pour peser les objets suivants :

5./

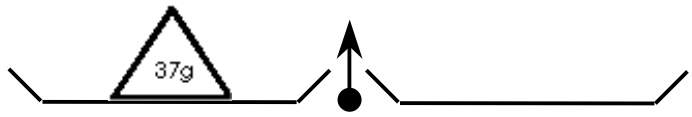

6./

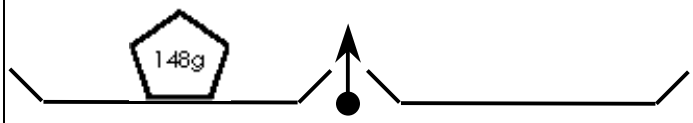

7./

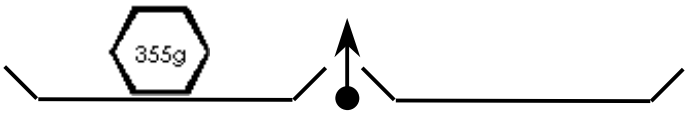

8./

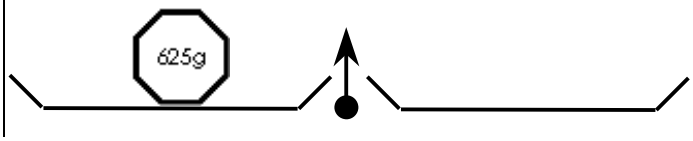

- Sélectionne les masses dont tu as besoins pour peser chaque objet :

	500g	200g	100g	100g	50g	20g	10g	10g	5g	2g	2g	1g
625 g	**X**			**X**		**X**			**X**			
142 g												
380 g												
768 g												
999 g												